Nature trail

1 The Junior Rangers find these pieces of litter on the nature trail. Find the approximate area of each.

(a)

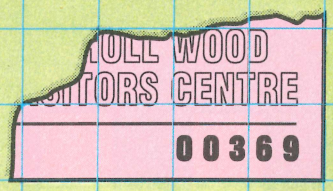

Area: about _____ cm²

(b)



Area: _____

(c)



Area: _____

2 Find the approximate area of each of these.

(a) Owl feather



Area: _____

(b) Duck feather

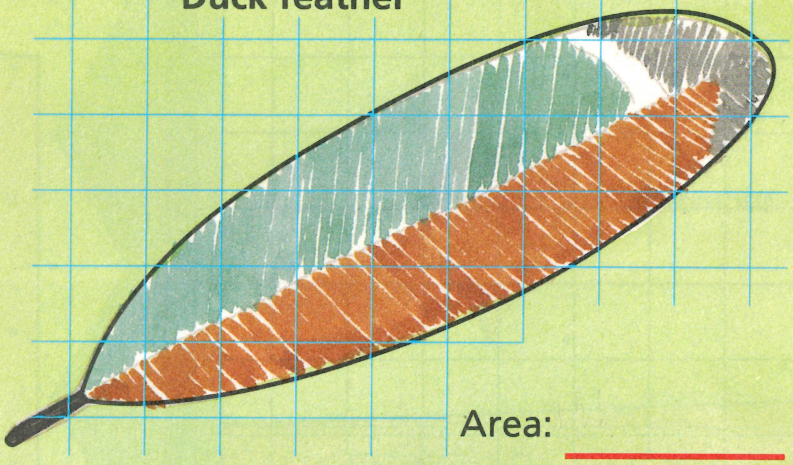

Area: _____

(c) Beech leaf



Area: _____

(d) Oak leaf

Area: _____